RESİMLİ KOLAY TOPLAMA İŞLEMLERİ

Aşağıdaki toplama işlemlerini örnekteki gibi boyayıp yapınız.

$$\begin{array}{r} 4 \\ +\ 6 \\ \hline 10 \end{array}$$



$$\begin{array}{r} 3 \\ +\ 5 \\ \hline \end{array}$$



$$\begin{array}{r} 8 \\ +\ 2 \\ \hline \end{array}$$



tamer_ogrt

7
+ 6
_____



8
+ 4
_____



15
+ 3
_____

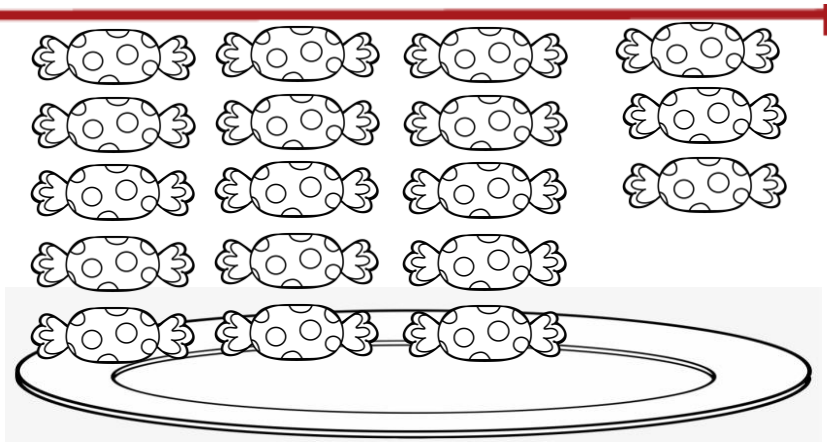

12
+ 4
_____



tamer_ogrt