BİRİM KÜPLER

Küpün kare şeklinde 6 eş yüzü vardır. Küpün açılımını inceleyiniz.

- Aşağıda verilen şekillerde kaç tane birim küp olduğunu hesaplayınız.

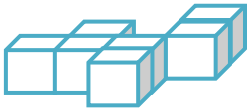

……. tane birim küp

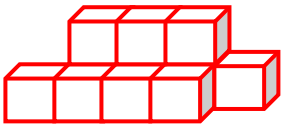

……. tane birim küp

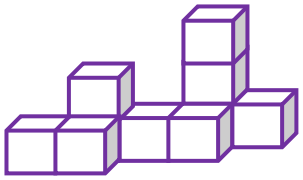

……. tane birim küp

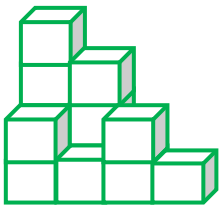

……. tane birim küp

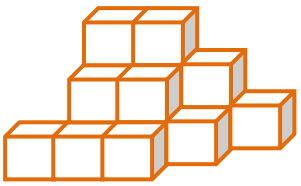

……. tane birim küp

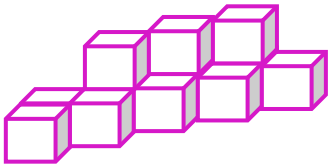

…. tane birim küp

İskender07

- Aşağıda verilen şekillerde kaç tane birim küp olduğunu hesaplayınız.

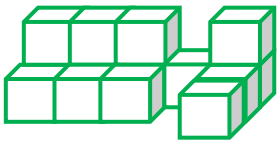

……. tane birim küp

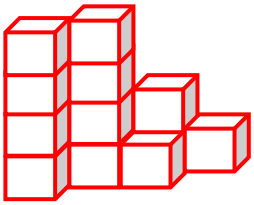

……. tane birim küp

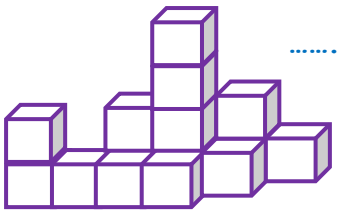

……. tane birim küp

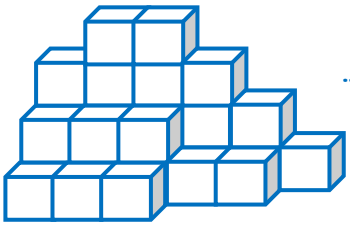

……. tane birim küp

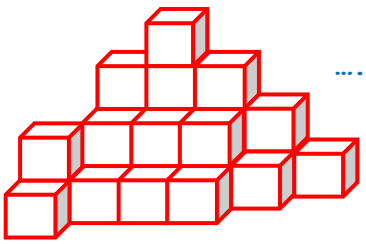

…. tane birim küp

İskender07